Place Value

Write how many tens and ones there are.

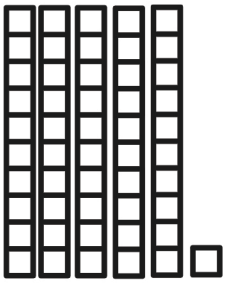

_____ tens _____ ones

_____ + _____ = _____

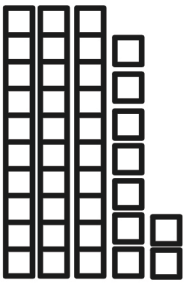

_____ tens _____ ones

_____ + _____ = _____

_____ tens _____ ones

_____ + _____ = _____

_____ tens _____ ones

_____ + _____ = _____



_____ tens _____ ones

_____ + _____ = _____

visit twinkl.com